Isomerie

C_5H_{12}

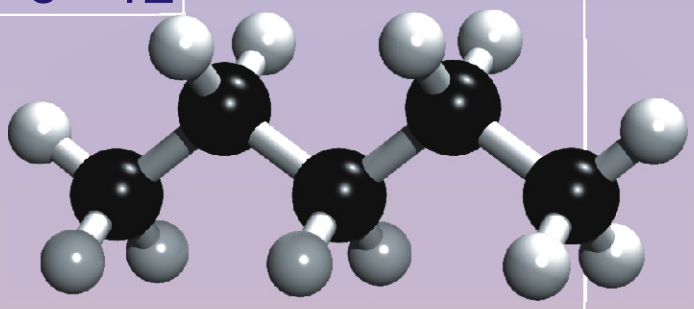

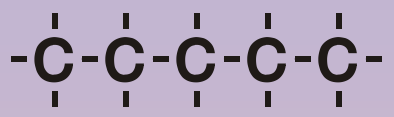

n - Pentan

C_5H_{12}

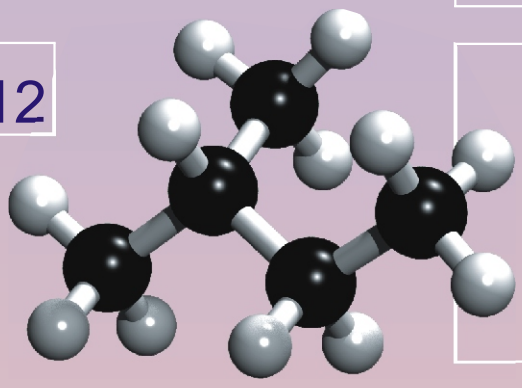

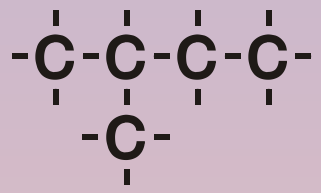

2 - Methylbutan

C_5H_{12}

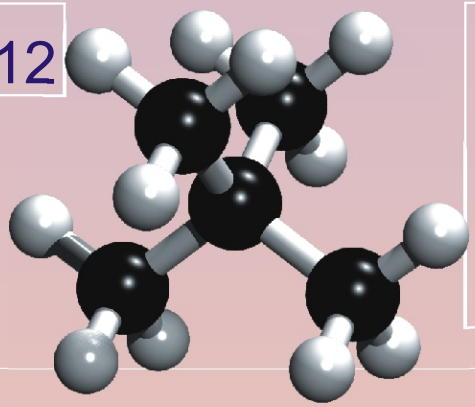

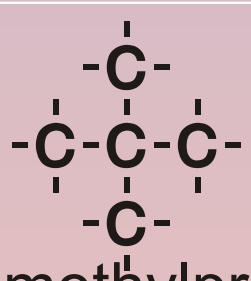

2,2 - Dimethylpropan

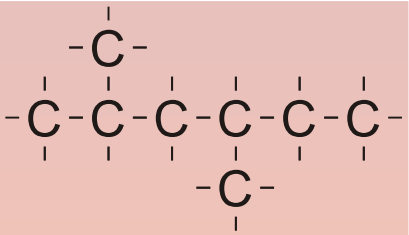

1. längste Kohlenstoffkette nummerieren
2. Alkylgruppen benennen
3. Anzahl der Alkylgruppen ermitteln
4. Position der Alkylgruppen angeben

2,4 - Dimethylhexan

Arbeitstransparente Chemie B. Köhler Fasanenweg 9 34626 Neukirchen